Rectangles and squares

Name: _____ Date: _____

Use the labelled lengths. Write the calculation and the correct unit.

1. A square has sides of 20 cm. Find its area.



2. A square has sides of 17 cm. Find its perimeter.



3. A square has sides of 16 cm. Find its perimeter.



4. A square has sides of 4 cm. Find its perimeter.



5. A square has sides of 5 cm. Find its perimeter.



6. A rectangle is 2 cm by 18 cm. Find its area.

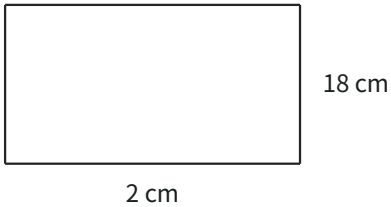

Rectangles and squares

Answer key

1. A square has sides of 20 cm. Find its area.

   $20 \times 20 = 400$ cm^2

   400 cm^2

2. A square has sides of 17 cm. Find its perimeter.

   $4 \times 17 = 68$ cm

   68 cm

3. A square has sides of 16 cm. Find its perimeter.

   $4 \times 16 = 64$ cm

   64 cm

4. A square has sides of 4 cm. Find its perimeter.

   $4 \times 4 = 16$ cm

   16 cm

5. A square has sides of 5 cm. Find its perimeter.

   $4 \times 5 = 20$ cm

   20 cm

6. A rectangle is 2 cm by 18 cm. Find its area.

   $2 \times 18 = 36$ cm^2

   36 cm^2